All rights reserved. No part of this publication may be reproduced, distributed, or transmitted in any form or by any means, electronic, mechanical, photocopying, recording or otherwise, or stored in any retrieval system of any nature without the permission of cracku.in, application for which shall be made to support@cracku.in

Downloaded from cracku.in

SSC CHSL 4th August 2021 Shift-3

English Language

1. **In the given sentence identify the segment which contains the grammatical error.**
   I would have died if he did not dress my wound that day.

A if he did not dress

B that day

C I would have died

D my wound

Answer: A

2. **Select the most appropriate word to fill in the blank.**
   Priya has a very _____ nature and does not accept financial help even from her own parents.

A impartial

B disinterested

C biased

D independent

Answer: D

3. **Select the most appropriate synonym of the given word.**
   Encroach

A Disregard

B Ignore

C Intrude

D Forget

Answer: C

4. **Sentences of a paragraph are given below in jumbled order. Arrange the sentences in the right order to form a meaningful and coherent paragraph.**
   A. Cheetahs are one of the world's most-recognisable cats, known especially for their speed.
   B. Their faces too are distinguished by prominent black lines that curve from the inner corner of each eye to the outer corners of the mouth, like a well-worn trail of inky tears.
   C. Cheetahs are covered almost entirely with small black spots on a background of pale yellow and have a white underbelly.
   D. They have a long, slender body measuring 1.2 metres (4 feet), with a long tail (65-85 cm [2-3 feet]) that generally ends in a white tuft.

A BADC

B ABDC

C DABC

D CADB

Downloaded from cracku.in

Answer: B

SSC CHSL Free Mock Test

5. **Select the most appropriate meaning of the given idiom.**
   Pull something off

A Drag something forcibly

B Take out the cover or lid

C Make something happen

D Make a lot of noise

Answer: C

6. **Select the most appropriate meaning of the given idiom.**
   Go to the dogs

A Fail miserably

B Deteriorate shockingly

C Want something badly

D Go crazy

Answer: B

7. **Select the option that can be used as a one-word substitute for the given group of words.**
   Fond of company

A Cheerful

B Gracious

C Gregarious

D Amiable

Answer: C

SSC CHSL Prevoius Papers (DOWNLOAD PDF)

8. **Select the most appropriate option to substitute the underlined segment in the given sentence. If there is no need to substitute it, select 'No improvement'.**
   <u>The child is crying</u> because she can't find her mother.

A No improvement

B A child is crying

C The child has cried

D The child were crying

Answer: A

Downloaded from cracku.in

9. **Select the INCORRECTLY spelt word.**

A Callous

B Vicious

C Hienous

D Vicarious

Answer: C

10. **Select the most appropriate ANTONYM of the given word.**
INDIGNANT

A Annoyed

B Pleased

C Upset

D Peeved

Answer: B

SSC CGL Previous Papers (DOWNLOAD PDF)

11. **Select the most appropriate ANTONYM of the given word.**
Harrowing

A Worrying

B Repetitive

C Pleasant

D Stressful

Answer: C

12. **Select the option that expresses the given sentence in direct speech.**
My friends say that many young people are very active on social media now.

A My friends say, “Many young people were very active on social media now.”

B My friends said, “Many young people were very active on social media then.”

C My friends say, “Many young people are very active on social media now.”

D My friends are saying, “Many young people are very active on social media then.”

Answer: C

13. **Select the most appropriate option to substitute the underlined segment in the given sentence. If there is no need to substitute it, select ‘No substitution required’.**
The roof <u>is being held up over</u> two stone pillars.

A is hold up on

Downloaded from cracku.in

B No substitution required

C was held above

D is held up by

Answer: D

SSC CGL Free Mock Test (Latest Pattern)

14. **Given below are four jumbled sentences. Out of the given options pick the one that gives their correct order.**
    A. He confessed that the only thing he was afraid of was snakes.
    B. On my second visit to West Africa I met a young man on board the ship.
    C. I told him that it was very unlikely that he would see any.
    D. He was going out to take up a job in a banana plantation.

A BDAC

B ADBC

C BACD

D DBAC

Answer: A

15. **Select the INCORRECTLY spelt word.**

A Entreat

B Entrust

C Envellope

D Envoy

Answer: C

16. **Select the word which means the same as the group of words given.**
    A person who arranges and sells cut flowers

A Botanist

B Anthropologist

C Horticulturist

D Florist

Answer: D

SSC CHSL Important Questions and Answers (Download PDF)

17. **Select the correct passive form of the given sentence.**
    At the last moment, a fireman pulled out Manohar from the burning bus.

A At the last moment, Manohar was pulling out of the burning bus by a fireman.

B At the last moment, Manohar was pulled out of the burning bus by a fireman.

Downloaded from cracku.in

C At the last moment, Manohar had been pulled out of the burning bus by a fireman.

D At the last moment, a fireman was pulled out of the burning bus by Manohar.

Answer: B

18. **Select the most appropriate word to fill in the blank in the given sentence.**
The passengers waited _____ for the local train to arrive.

A hastily

B meekly

C patiently

D considerably

Answer: C

19. **Select the most appropriate synonym of the given word.**
APPARENTLY

A Seemingly

B Considerably

C Unlikely

D Questionably

Answer: A

SSC CHSL Study Material

20. **The following sentence has been divided into parts. One of them may contain an error. Select the part that contains the error from the given options. If you don't find any error, mark 'No error' as your answer.**
At the workshop, / they were taught how to nail / the pieces of wood together to create toys.

A No error

B they were taught how to nail

C the pieces of wood together to create toys

D At the workshop

Answer: A

Instructions [21 - 25]

In the following passage some words have been deleted. Fill in the blanks with the help of the alternatives given. Select the most appropriate option for each blank.

Comprehension:
Equiano was born in 1745 in Nigeria. When he (1) _____ about eleven, Equiano was kidnapped and sold to slave traders headed (2) _____ the West Indies. Though he spent a brief (3) _____ in the state of Virginia, much of Equiano's time (4) _____ serving on slave ships and British navy vessels. In his service on these (5) _____, Equiano traveled extensively.

21. **Select the most appropriate option for blank number 1.**

A is

Downloaded from cracku.in

B were

C are

D was

Answer: D

22. **Select the most appropriate option for blank number 2.**

A on

B to

C in

D about

Answer: B

SSC CHSL Free App

23. **Select the most appropriate option for blank number 3.**

A era

B age

C period

D life

Answer: C

24. **Select the most appropriate option for blank number 4.**

A spent

B was spent

C is spent

D has been spent

Answer: B

25. **Select the most appropriate option for blank number 5.**

A liners

B crafts

C tankers

D ships

Answer: D

Daily Free SSC Practice Set

Downloaded from cracku.in

26. **Nirmala introduced Rahul as the son of the sister of her mother. How is Nirmala related to Rahul?**

A Brother

B Brother-in-law

C Cousin

D Maternal uncle

Answer: C

Free SSC Study Material (18,000 Solved Questions)

27. **Which two signs should be interchanged to balance the following equation?**
$646 \div 19 - 746 + 20 \times 34 = 10$

A $-$ and $\times$

B $\times$ and $+$

C $-$ and $+$

D $\times$ and $\div$

Answer: C

28. **Select the correct option that indicates the arrangement of the given words in a logical and meaningful order.**
1. Prescription
2. Diagnosis
3. Illness
4. Follow-up
5. Recovery

A 3-4-1-2-5

B 1-2-5-3-4

C 3-2-1-5-4

D 2-3-1-4-5

Answer: C

29. **Four letter-clusters have been given, out of which three are alike in some manner and one is different. Select the letter-cluster that is different.**

A PVBH

B CIOU

C SYDJ

D KQWC

Answer: C

Downloaded from cracku.in

30. **In a certain code language, CANDIDATE is coded as 846292417 and ACTION is coded as 481936. How will DICTATION be coded in that language?**

A 493212965

B 298242956

C 493212975

D 298141936

Answer: D

31. **Select the Venn diagram that best represents the relationship between the following classes.**
Teachers, Graduates, Tennis players

A 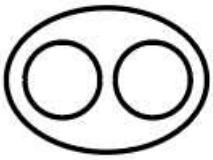

B 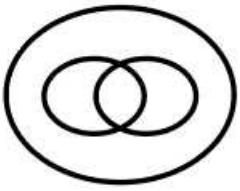

C 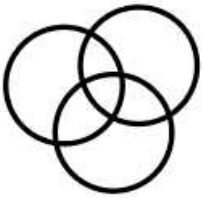

D 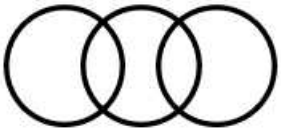

Answer: C

32. **Three different positions of the same dice are shown. Select the number that will be on the face opposite to the face having 6.**

A 2

B 4

C 3

D 1

Answer: A

Downloaded from cracku.in

33. **Select the figure from among the given options that can replace the question mark (?) in the following series.**

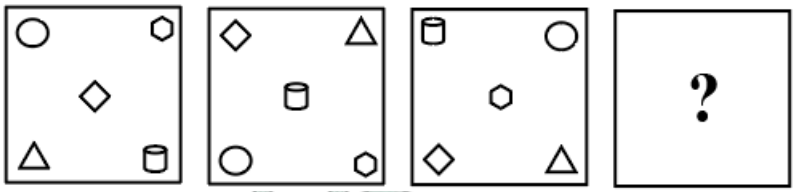

A

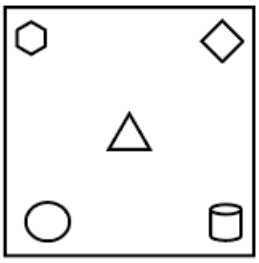

B

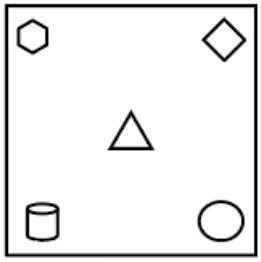

C

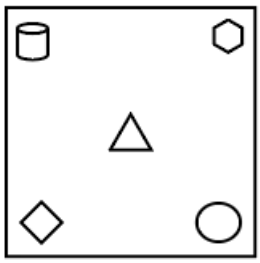

D

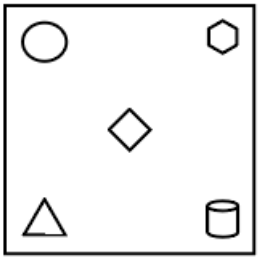

Answer: B

34. **Select the option that is related to the third word in the same way as the second word is related to the first word.**
Galvanometer : Electric current : : Graphometer : ?

A Angles

B Oscillations

C Altitudes

D Humidity

Answer: A

35. **In a certain code language, PROUD is written as WYJPK. How will GUILTY be written in that language?**

Downloaded from cracku.in

A BPBOGT

B NDPASF

C NPDSAF

D BBPGOT

Answer: C

Latest Job Updates on Telegram - Join here

36. **From the given options choose the one in which the set of numbers do not follow the same Logic/Rule/Relation as the numbers given in below set.**
(32, 16, 96)

A (42, 21, 126)

B (26, 13, 78)

C (36, 18, 108)

D (22, 11, 68)

Answer: D

37. **Select the option in which the numbers share the same relationship as that shared by the given pair of numbers.**
185 : 199

A 139 : 152

B 174 : 187

C 126 : 134

D 89 : 106

Answer: D

38. **Select the option in which the words share the same relationship as that shared by the given pair of words.**
Power : Watt

A Current : Volt

B Force : Pascal

C Volume : Pound

D Resistance : Ohm

Answer: D

Join SSC Daily Quiz Telegram Group

39. **Select the number from among the given options that can replace the question mark (?) in the following series.**
4, 5, 13, 22, 86, 111, ?

Downloaded from cracku.in

A 327

B 427

C 247

D 237

Answer: A

40. **Four numbers have been given, out of which three are alike in some manner and one is different. Select the number that is different.**

A 348

B 231

C 252

D 217

Answer: A

41. **A driver increases the speed of his vehicle by 5 km/h after every one hour. If the initial speed of the vehicle was 75 km/h, then what was the average speed of the vehicle in a journey of 4 hours?**

A 82.5 km/h

B 83.75 km/h

C 83 km/h

D 82 km/h

Answer: A

42. **Read the given statements and conclusions carefully. Assuming that the information given in the statements is true, even if it appears to be at variance with commonly known facts, decide which of the given conclusions logically follow(s) from the statements.**
Statements:
All plots are flats.
All flats are hotels.
Some hotels are restaurants.
Conclusions:
I. Some restaurants are flats.
II. Some hotels are plots.
III. No plot is a restaurant.

A Only conclusion I follows.

B Only conclusion II follows.

C Both conclusions I and II follow.

D Both conclusions II and III follow.

Answer: B

43. **Select the option that is related to the third term in the same way as the second term is related to the first term.**
AMIDST : AIMDST : : SYNTAX : ?

Downloaded from cracku.in

A SNYATX

B NYSTAX

C SANYTX

D NSYATX

Answer: D

44. **The sequence of folding a piece of paper and the manner in which the folded paper has been cutis shown in the following figures. How would this paper look when unfolded?**

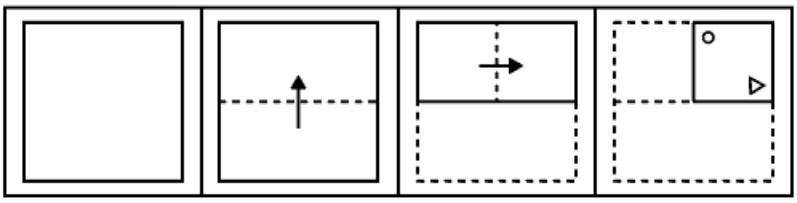

A

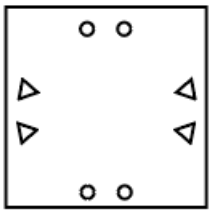

B

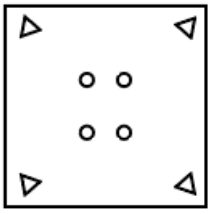

C

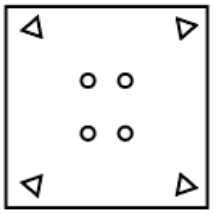

D

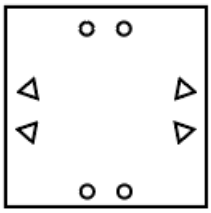

Answer: D

SSC CHSL Free Mock Test

45. **Select the combination of letters that when sequentially placed in the blanks of the given letter series will complete the series.**
p l _ p p _ s p _ l s p p l _ p

A s p p l

B s l p s

Downloaded from cracku.in

C l s l p

D p l s p

Answer: B

46. **Four words have been given, out of which three are alike in some manner and one is different. Select the word that is different.**

A Fluster

B Confound

C Agitate

D Calm

Answer: D

47. **How many rectangles are there in the given figure?**

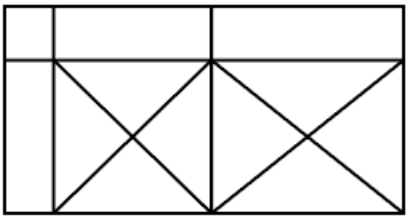

A 18

B 20

C 16

D 19

Answer: A

SSC CHSL Prevoius Papers (DOWNLOAD PDF)

48. **Select the option in which the numbers are related in the same way as are the numbers of the following set.**
(2194, 1328, 726)

A (1170, 570, 228)

B (1560, 1131, 551)

C (1406, 962, 390)

D (1725, 997, 509)

Answer: D

49. **Select the correct mirror image of the given combination when the mirror is placed at 'PQ' as shown.**

Downloaded from cracku.in

A

B

C

D

Answer: D

50. **Select the option in which the given figure is embedded (rotation is NOT allowed).**

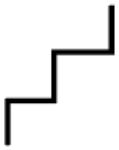

A 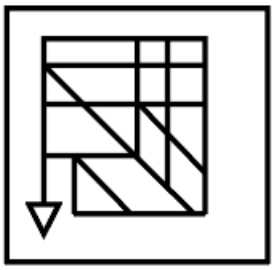

B 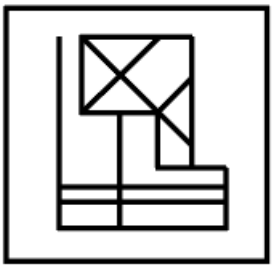

C 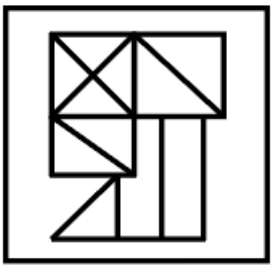

D 

Answer: A

SSC CGL Previous Papers (DOWNLOAD PDF)

Quantitative Aptitude

51. **When $(2^{24} - 1)$ is divided by 7, the remainder is:**

Downloaded from cracku.in

A 2

B 0

C 4

D 1

Answer: B

SSC CGL Free Mock Test (Latest Pattern)

52. **If** $a+b+c=7$ **and** $a^3+b^3+c^3-3abc=301$, **then** $ab+bc+ca=?$

A -4

B -2

C 3

D 2

Answer: D

53. **Study the given graph and answer the question that follows.**

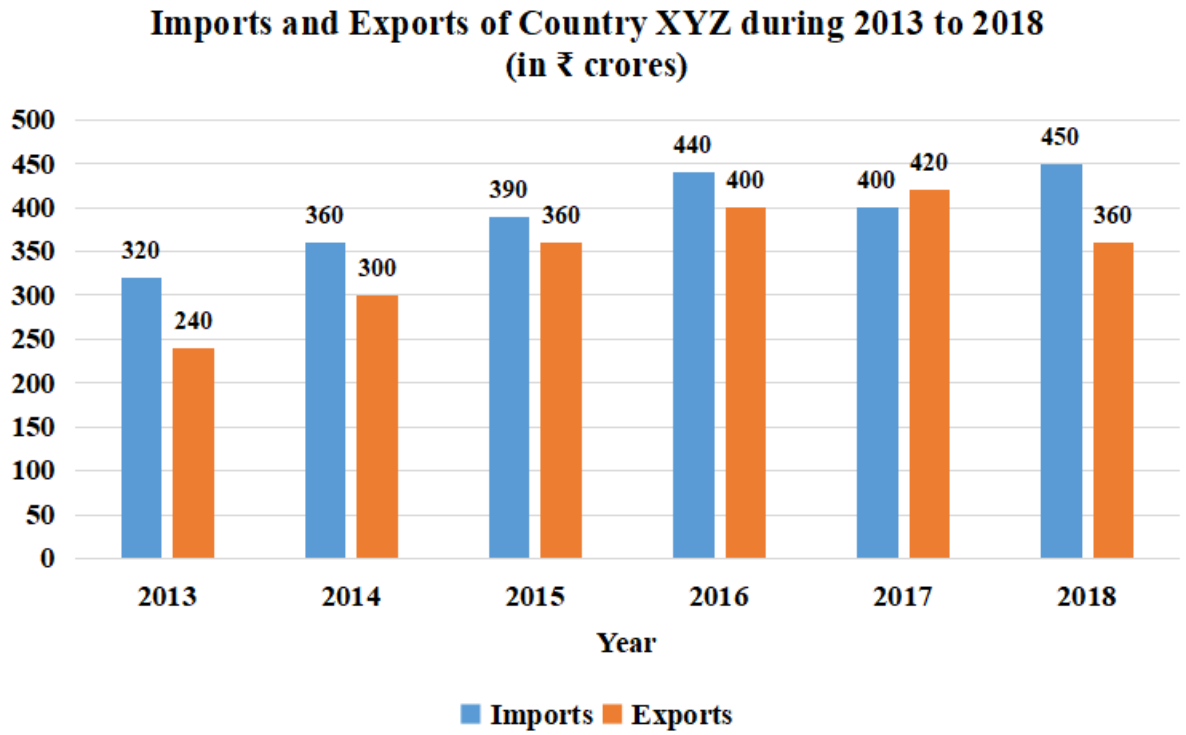

By what percentage is the total exports in 2014 and 2016 less than the total imports in the same two years?

A 12.5

B 12.9

C 14.3

D 11.25

Answer: A

Downloaded from cracku.in

54. Ina circle with centre O , chord AB and diameter CD intersect each otherat pointE , inside the circle. If $\angle AOD = 42^\circ$ and $\angle BOC = 104^\circ$, then what is the measure (in degrees) of $\angle AED$?

A 73

B 62

C 58

D 84

Answer: A

SSC CHSL Important Questions and Answers (Download PDF)

55. If $x^2 - 3\sqrt{2}x + 1 = 0$, then what is the value of $x^3 + \left(\frac{1}{x^3}\right)$?

A $30\sqrt{6}$

B $45\sqrt{2}$

C $15\sqrt{6}$

D $30\sqrt{2}$

Answer: B

56. If $x^2 + 1 - 2x = 0, x > 0$, then $x^2(x^2 - 2) = ...$

A 1

B $\sqrt{2}$

C -1

D 0

Answer: C

57. Chords AB and CD of a circle intersect externally at P. If CD = 11.6 cm, PD = 6.4 cm and PB = 7.2 cm, then AB (in cm) is equal to:

A 12

B 16

C 8.8

D 4.8

Answer: C

SSC CHSL Study Material

58. If $2\cos^2\theta = 3(1 - \sin\theta), 0^\circ < \theta < 90^\circ$, then what is the value of $(\tan 2\theta + \operatorname{cosec} 3\theta - \sec 2\theta)$?

Downloaded from cracku.in

A $\sqrt{3}+1$

B $\sqrt{3}-1$

C $\frac{1+\sqrt{3}}{\sqrt{3}}$

D $\frac{1-\sqrt{3}}{\sqrt{3}}$

Answer: B

59. **The value of** $8 \div 2of3 - [56 \div 4of\{4 \times 3 - (9-11) \div (2 \div 4of4)\}]$ **is:**

A $\frac{11}{6}$

B $\frac{5}{6}$

C $\frac{4}{3}$

D $\frac{1}{2}$

Answer: B

60. **The perimeters of two similar triangles ABC and PQRare 156 cm and 46.8 cm, respectively. If BC = 19.5 cm and QR = x cm, then the valueof x is:**

A 5.85 cm

B 6.75 cm

C 3.76 cm

D 4.29 cm

Answer: A

SSC CHSL Free App

61. **A can complete a certain work in 30 days. Hestarted the work. After 4 days, B joined him and the whole work was completed in 10 days from the beginning. B alone can complete one-third of the same work in:**

A 6 days

B 3 days

C 4 days

D 2 days

Answer: B

62. **If the difference between the compound interest compounded annually and the simple interest on a certain sum of moneyfor three years at 10%per annum is ₹279, then the sum (in ₹)is:**

A 10,000

B 8,000

Downloaded from cracku.in

C 7,500

D 9,000

Answer: D

63. **In $\triangle ABC, \angle A = 90^\circ, AB = 20$ cm and BC = 29 cm. What is the value of $(\sin B - \cot C)$?**

A $-\frac{9}{29}$

B $-\frac{189}{580}$

C $\frac{189}{580}$

D $\frac{9}{29}$

Answer: B

Daily Free SSC Practice Set

64. **In a constituency, 55% of the total number of voters are males and the rest are females. If 40% of the males are illiterate and 40% of the females are literate, then by what percentage is the number of illiterate females more than that of the illiterate males (correct to one decimal place)?**

A 22.7%

B 16.4%

C 21.5%

D 20.8%

Answer: A

65. **By selling 3 dozen oranges for ₹405, a trader loses 25%. How many oranges should hesell for ₹288 if he needs to earn a profit of 20% in the transaction?**

A 18

B 15

C 16

D 12

Answer: C

66. **X and start at the same time to ride from place A to place B, which is 80 km away from A. X travels 4 km per hour slowerthan Y. Y reaches place B and at once turns back meeting X, 16 km from place B. Y's speed (in km/h)is:**

A 9

B 15

C 8

D 12

Answer: D

Downloaded from cracku.in

67. There are three numbers. If the ratio of the first to the second number is 2 : 7 and that of the second to the third number is 5 : 8, then the ratio of the first to the third number is:

A 7 : 8

B 5 : 28

C 1 : 4

D 5 : 7

Answer: B

68. Study the given graph and answer the question that follows.

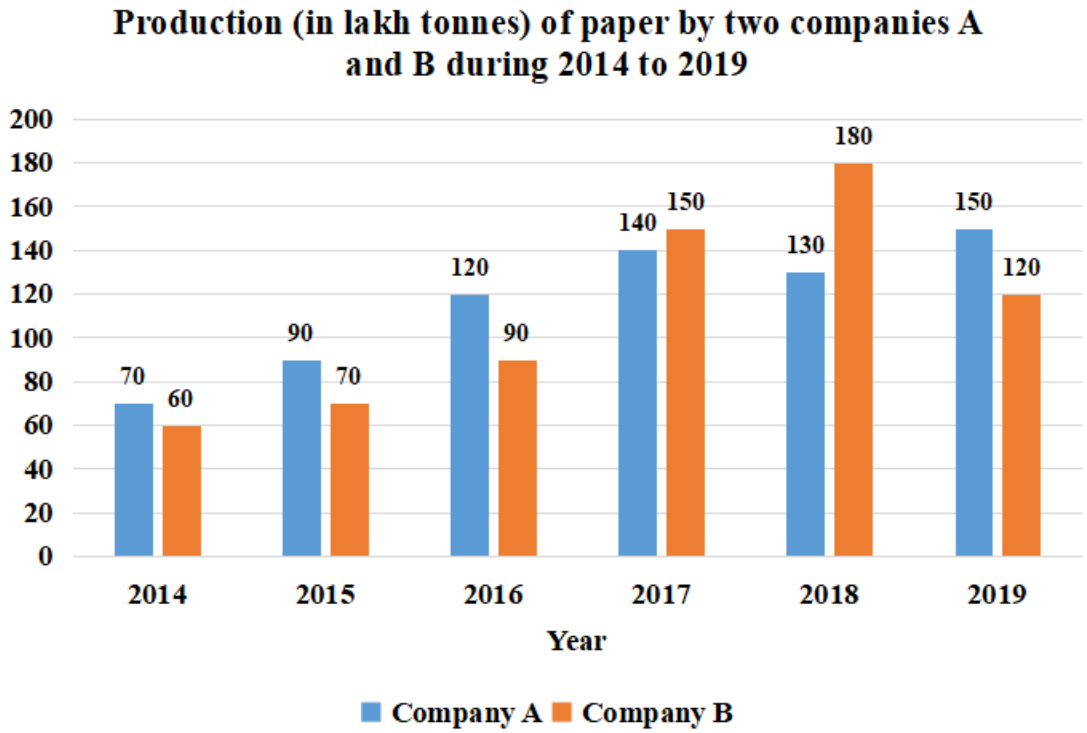

What is the ratio of the total production of paper by company A in 2016 and 2019 to the total production of paper by company B in 2014 and 2017?

A 9 : 7

B 3 : 2

C 5 : 4

D 8 : 5

Answer: A

69. BD and CE are the medians of $\triangle ABC$, right angled at A. If $CE = \frac{5\sqrt{13}}{2}$ cm, BC = 10 cm, then the length of BD is:

A $3\sqrt{7}$ cm

B $3\sqrt{5}$ cm

Downloaded from cracku.in

C $\sqrt{13}$ cm

D $\frac{5}{2}\sqrt{7}$ cm

Answer: D

1500+ Very Important Free SSC Solved Questions

70. **The following histogram represents the daily earnings of 50 medical stores in a locality.**

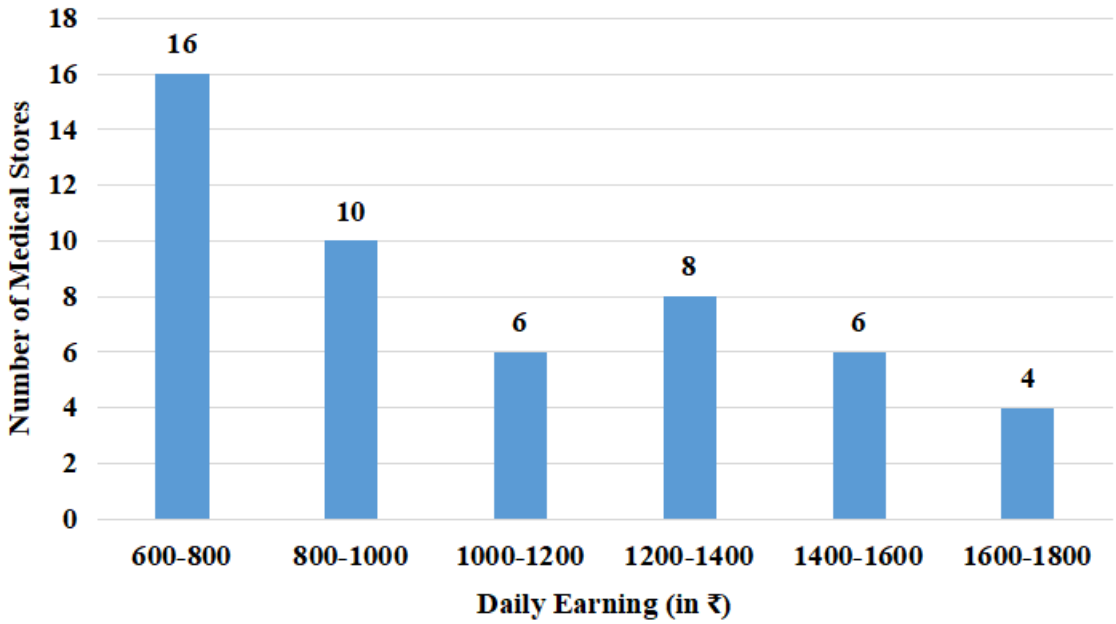

The difference between the percentage of medical stores whose daily earnings are less than ₹1,000 and the percentage of medical stores whose daily earnings are ₹1,200 and above is:

A 24%

B 16%

C 15%

D 12%

Answer: B

71. **The marked price of an article is ₹480. A person buysit at two successive discounts of 15% and 10%. He sells it at a profit of 25%, Whatis his profit (in ₹)?**

A 95.40

B 90.60

C 91.80

D 93.20

Answer: C

72. **The average of 19 numbers is 48. The averageofthe first 7 numbers is 50.6 and that ofthe last 13 numbers is 47.6. If the 7th number is excluded, then what is the average of the remaining numbers (correct to one decimal place)?**

A 42.4

Downloaded from cracku.in

B 49.5

C 39.6

D 47.3

Answer: D

SSC Exam Update Videos & Free Study Material (YouTube Channel)

73. **Study the following bar graph and answer the question given below.**
The bar graph represents the total number of applications received for B.Sc. Mathematics by two different colleges A and B in 5 different years.

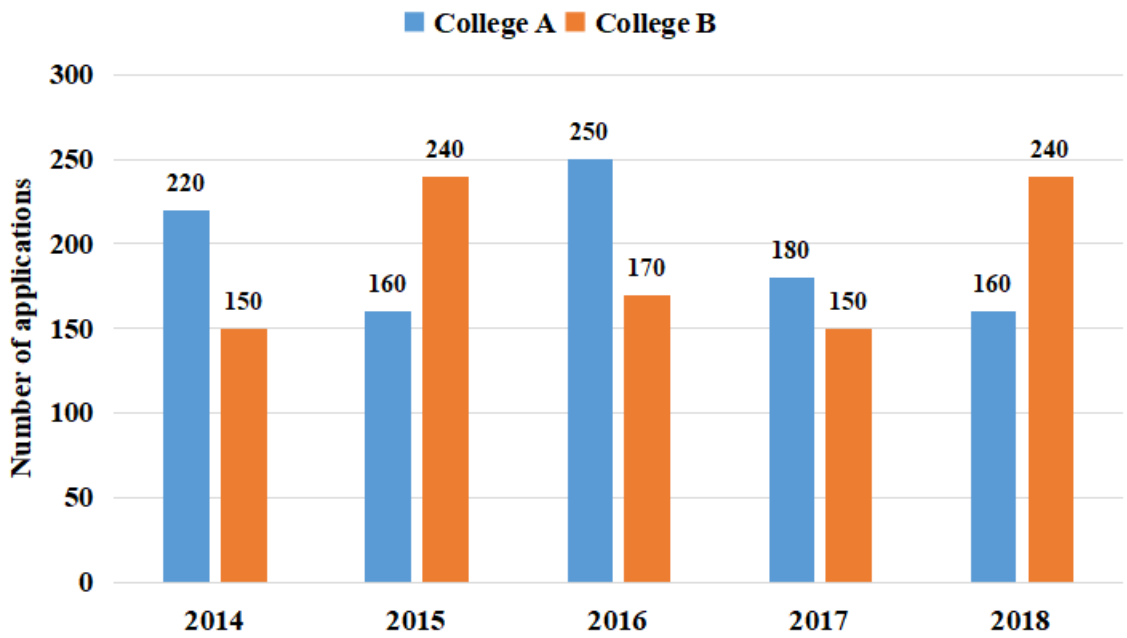

Find the difference between the average number of applications received by college A from 2014 to 2018 and the average number of applications received by college B from 2014 to 2018?

A 5

B 4

C 6

D 8

Answer: B

74. **As observed from the top of a lighthouse, 42 m high abovesea-level, the angle of depression of a ship sailing directly towards it changes from 30° to 45°. The distance travelled by the ship during the period of observation is:**

A $42(1-\sqrt{3})$

B $42(\sqrt{3}+1)$

C $42(\sqrt{3}-1)$

D 42

Answer: C

75. **What is the cost(in ₹) of levelling a triangular park with sides 60 m , 112 m and 164 m atthe rate of ₹10.50 per m ^{2} ?**

Downloaded from cracku.in

A 21,063

B 20,160

C 21,168

D 21,000

Answer: C

Latest Job Updates on Telegram - Join here

General Awareness

76. **According to which of the following Schedules to the Constitution provides for allocation of seats to the states and union territories in Rajya Sabha?**

A Fourth

B Sixth

C Seventh

D Second

Answer: A

Join SSC Daily Quiz Telegram Group

77. **Which of the following rivers rises in the west of Rohtang Pass in the Kullu hills of Himachal Pradesh and flows through the Chamba valley of the state?**

A Satluj

B Ravi

C Beas

D Chenab

Answer: B

78. **How many Rajya Sabha seats come from the state of Assam?**

A 7

B 15

C 9

D 18

Answer: A

79. **In which of the following years was the Cornwallis Code enacted?**

A 1857

Downloaded from cracku.in

B 1793

C 1805

D 1723

Answer: B

80. **Which of the following is the full form of EBCDIC?**

A Extended Binary-Coded-Decimal Interchange Code

B Extended Binary-Control-Device Interchange Code

C Electronic Binary-Coded-Device Interchange Code

D Electronic Binary-Control-Decimal Interchange Code

Answer: A

81. **Which of the following factors is NOT responsible for the loss of fertility of agricultural land?**

A Salinisation of soil

B Higher cation exchange capacity of soil

C Alkalisation of soil

D Waterlogging

Answer: B

82. **Which of the following banks has signed a loan of $40 million to Northern Arc Capital to support the microfinance borrowers and the MSME sectors in India?**

A AIIB

B World Bank

C IMF

D ADB

Answer: D

SSC CHSL Free Mock Test

83. **Which of the following devices accepts the results produced by the computer in a machine-readable form?**

A Microphone

B Printer

C Graphics tablet

D Mouse

Answer: B

Downloaded from cracku.in

84. **Kuldeep Handoo has won the Dronacharya Award in 2020. He belongs to which of the following sports?**

A Wushu

B Swimming

C Boxing

D Wrestling

Answer: A

85. **Which of the following is one of the basic plant nutrients of fertilizers that are commonly used in agriculture?**

A Sodium

B Mercury

C Arsenic

D Potassium

Answer: D

SSC CHSL Prevoius Papers (DOWNLOAD PDF)

86. **Who among the following has written the novel 'The Awasthis of Aamnagri'?**

A Shubha Sharma

B Debashish Panigrahi

C Sarabjit Singh

D Chetan Bhagat

Answer: A

87. **The 'SAKSHAM' campaign launched by the Government of India in January 2021 aims to spread awareness about _____.**

A adoption of cleaner fuels

B empowerment of women

C protection of girl child

D education for children

Answer: A

88. **Who among the following footballers won the 'Best FIFA Men's Player Award' 2020?**

A Lionel Messi

B Cristiano Ronaldo

C Robert Lewandowski

Downloaded from cracku.in

D Raheem Sterling

Answer: C

SSC CGL Previous Papers (DOWNLOAD PDF)

89. **Shigmotsav is essentially a festival of the masses, celebrated on the full moon day in the month of Phalguna (March). Which state celebrates this festival?**

A Haryana

B Meghalaya

C Sikkim

D Goa

Answer: D

90. **India has engaged actively in the multilateral negotiations in the UNFCCC. What is the full form of UNFCCC?**

A United Nations Framework of Central Climate Change

B United Nations Fellowship of Central Climate Change

C United Nations Framework Convention on Climate Change

D United Nations Fellowship Convention on Climate Change

Answer: C

91. **Suryadhar lake is located in which of the following states?**

A Himachal Pradesh

B Arunachal Pradesh

C Uttarakhand

D Meghalaya

Answer: C

SSC CGL Free Mock Test (Latest Pattern)

92. **Which of the followings sports was added to the Asian Beach Games Program 2021 as of December 2020?**

A Athletics

B Aquatics

C Basketball

D Coastal Rowing

Answer: A

93. **In which of the following states is Buxa National Park situated?**

Downloaded from cracku.in

A Punjab

B Haryana

C Karnataka

D West Bengal

Answer: D

94. **Which of the following states Government has unveiled the 'Farmer Registration and Unified beneficiary Information System' (FRUITS), an e-governance portal, to create a repository of farmland information and farm loan details on a single platform?**

A Karnataka

B Tamil Nadu

C Kerala

D Chhattisgarh

Answer: A

SSC CHSL Important Questions and Answers (Download PDF)

95. **In which of the following cities was India's first indigenously designed and developed driverless metro car unveiled in January 2021?**

A Delhi

B Chennai

C Kolkata

D Bengaluru

Answer: D

96. **Who among the following were awarded the Nobel Prize 2020 in Economics Sciences?**

A James J Heckman and Daniel L McFadden

B Paul R Milgrom and Robert B Wilson

C William Vickrey and James A Mirrlees

D Robert W Fogel and Douglass C North

Answer: B

97. **Which of the following battles did Maulvi Ahmadullah Shah fight, defeating the forces under Henry Lawrence?**

A Battle of Kintoor

B Battle of Saragarhi

C Battle of Chinhat

D Battle of Najafgarh

Downloaded from cracku.in

Answer: C

SSC CHSL Study Material

98. **Which of the following is used as a primary means of implementing the monetary policy of the Reserve Bank of India?**

A Repo rate

B Call money

C Mumbai Interbank Offer Rate

D Promissory notes

Answer: A

99. **In which of the following states is Sri Bhramaramba Mallikarjuna Temple located?**

A Andhra Pradesh

B Odisha

C Maharashtra

D Tamil Nadu

Answer: A

100. **Which of the following diseases is caused by Helicobacter pyroli?**

A Gastritis

B Ringworm

C Chikungunya

D Rubella

Answer: A

SSC CHSL Free App

SSC CHSL Free Mock Test

SSC CHSL Prevoius Papers (DOWNLOAD PDF)

SSC CGL Previous Papers (DOWNLOAD PDF)

SSC CGL Free Mock Test (Latest Pattern)

SSC CHSL Important Questions and Answers (Download PDF)

Downloaded from cracku.in

SSC CHSL Study Material

SSC CHSL Free App

Daily Free SSC Practice Set

Free SSC Study Material (18,000 Solved Questions)

1500+ Very Important Free SSC Solved Questions

SSC Exam Update Videos & Free Study Material (YouTube Channel)

Latest Job Updates on Telegram - Join here

Join SSC Daily Quiz Telegram Group

Downloaded from cracku.in